Anv bihan : ……..……..…….. Deiziad : ……..……..

MESURE	**AN HIRDERIOÙ** An unanderioù a hirder – Poelladennoù (02)

1./ Pegement **hir** eo ar segmantoù-se ? Skriv an disoc'hoù en daolenn ba'n traoñ.

A _____ B



C _____ D

E _____ F



G _____ H

I _____ J

[AB] **6 cm ha 5 mm**	[CD] ..... cm et ..... mm	[EF] ..... cm et ..... mm	[GH] ..... cm et ..... mm	[IJ] ..... cm et ..... mm

2./ Pegement **hir** eo ar segmantoù-se ? Skriv an disoc'hoù en daolenn ba'n traoñ.

K _____ L

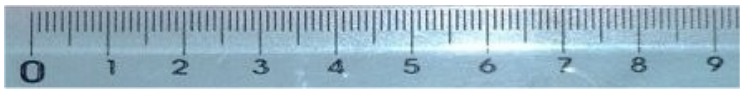

M _____ N

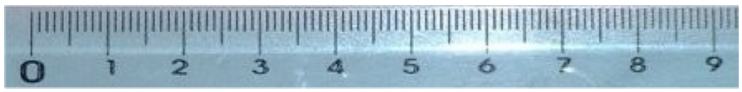

O _____ P

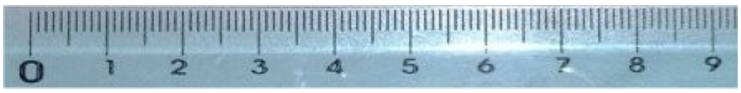

Q _____ R

S _____ T

[KL] **5 cm ha 3 mm**	[MN]	[OP]	[QR]	[ST] .....

3./ Reñkañ ar segmantoù-se deus an hini **hirañ** d'an hini **berrañ**.

ST	.....	.....	.....	.....	.....	.....	.....	.....	**KL**