Prénom : …… Date : ……

LES MASSES (05)

L'utilisation d'une balance

- Voici les poids contenus dans une boîte de masses marquées :

1./ Quelle est la masse des objets suivants ?

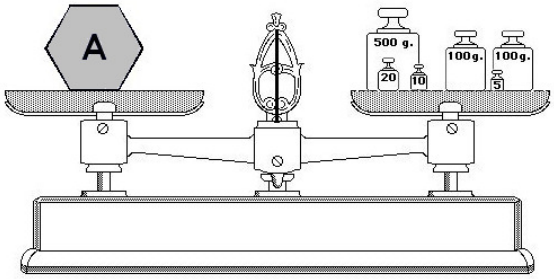

Masse de A : .....

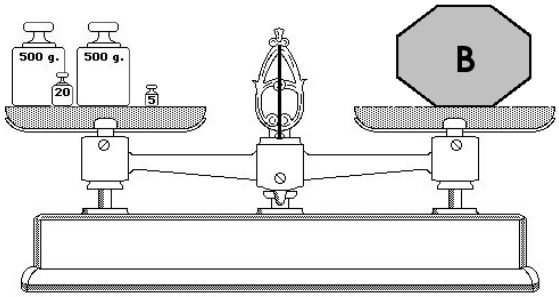

Masse de B : .....

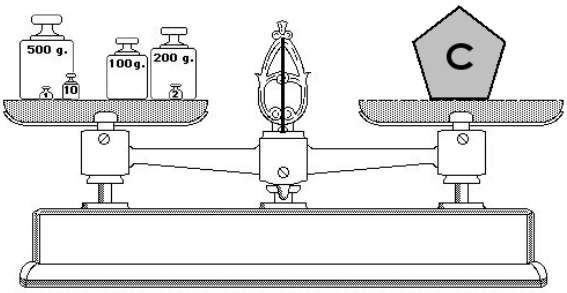

Masse de C : .....

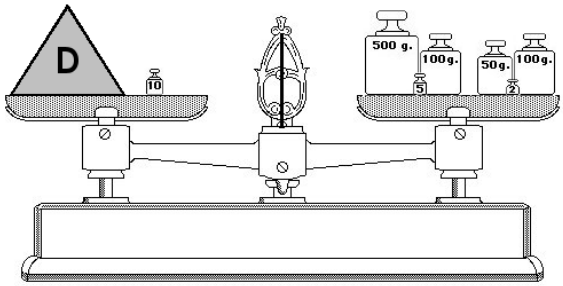

Masse de D : .....

2./ Quels poids dois-tu utiliser pour équilibrer ces balances ?

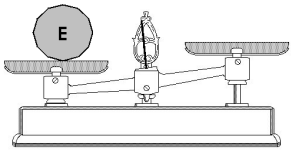

1 - E = 478 g

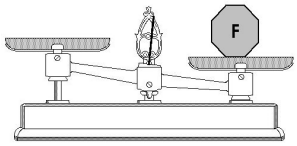

2 - F = 39 dag 4 g

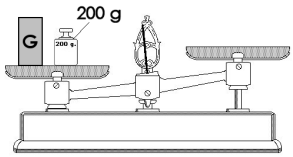

3 - G = 3 hg 7 g

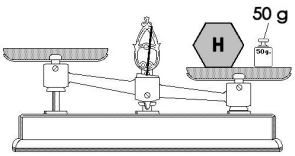

4 - H = 65 dag 2 g

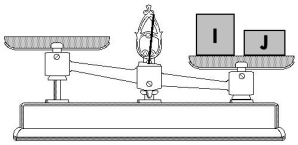

5 - I = 5 hg J = 17 dag 6 g

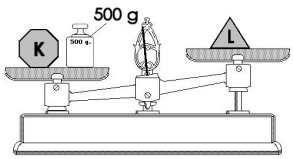

6 - K = 480 dg L = 200 g

	500	200	100	100	50	20	10	10	5	2	2	1
1												
2												
3		-										
4					-							
5												
6	-											