Anv bihan : ……..……..…….. Deiziad : ……..……..

MESURE	**AN HIRDERIOÙ** An unanderioù a hirder – Poelladennoù (01)

1./ Pegement **hir** eo ar segmantoù-se ? Skriv an disoc'hoù ba'n daolenn en traoñ.

A _____ B



C _____ D

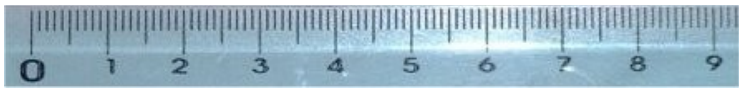

E _____ F

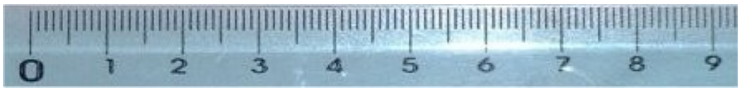

G _____ H

I _____ J

[AB] **5 cm**	[CD]	[EF]	[GH]	[IJ]
	.....	.....	.....	.....

2./ Pegement **hir** eo ar segmantoù-se ? Skriv an disoc'hoù ba'n daolenn en traoñ.

K _____ L



M _____ N

O _____ P

Q _____ R

S _____ T

[KL] **3 cm 5 mm**	[MN]	[OP]	[QR]	[ST]
	.....	.....	.....	.....

3./ Laka en urzh ar segmantoù-se deus an hini **berrañ** d'an hini **hirañ** :

QR	.....	.....	.....	.....	.....	.....	.....	.....	**IJ**